Pearson Edexcel

Topic Test
Summer 2022

Pearson Edexcel GCE Mathematics (9MA0)

Paper 1 and Paper 2

Topic 10: Vectors

Contents

General guidance to Topic Tests 3

Revise Revision Guide content coverage 4

Questions 5

Mark Scheme 19

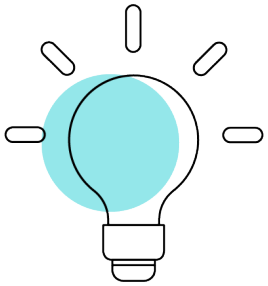

Questions

Question T10_Q1

2. Relative to a fixed origin O,

the point A has position vector $(2\mathbf{i} + 3\mathbf{j} - 4\mathbf{k})$,

the point B has position vector $(4\mathbf{i} - 2\mathbf{j} + 3\mathbf{k})$,

and the point C has position vector $(a\mathbf{i} + 5\mathbf{j} - 2\mathbf{k})$, where a is a constant and $a < 0$

D is the point such that $\overrightarrow{AB} = \overrightarrow{BD}$.

(a) Find the position vector of D.

(2)

Given $|\overrightarrow{AC}| = 4$

(b) find the value of a.

(3)

Question 2 continued

Question T10_Q2

10.

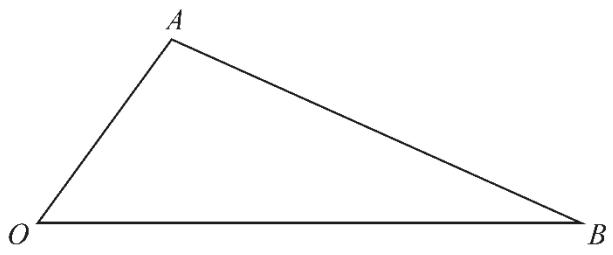

Figure 7

Figure 7 shows a sketch of triangle OAB.

The point C is such that $\overrightarrow{OC} = 2\overrightarrow{OA}$.

The point M is the midpoint of AB.

The straight line through C and M cuts OB at the point N.

Given $\overrightarrow{OA} = \mathbf{a}$ and $\overrightarrow{OB} = \mathbf{b}$

(a) Find $\overrightarrow{CM}$ in terms of **a** and **b**

(2)

(b) Show that $\overrightarrow{ON} = \left(2 - \frac{3}{2}\lambda\right)\mathbf{a} + \frac{1}{2}\lambda\mathbf{b}$, where λ is a scalar constant.

(2)

(c) Hence prove that $ON : NB = 2 : 1$

(2)

Question 10 continued

Question 10 continued

Question 10 continued

Question T10_Q3

3. Relative to a fixed origin O

- point A has position vector $2\mathbf{i} + 5\mathbf{j} - 6\mathbf{k}$
- point B has position vector $3\mathbf{i} - 3\mathbf{j} - 4\mathbf{k}$
- point C has position vector $2\mathbf{i} - 16\mathbf{j} + 4\mathbf{k}$

(a) Find $\overrightarrow{AB}$

(2)

(b) Show that quadrilateral $OABC$ is a trapezium, giving reasons for your answer.

(2)

Question 3 continued

Question T10_Q4

2. Relative to a fixed origin, points P, Q and R have position vectors $\mathbf{p}$, $\mathbf{q}$ and $\mathbf{r}$ respectively.

Given that

- P, Q and R lie on a straight line
- Q lies one third of the way from P to R

show that

$$\mathbf{q} = \frac{1}{3}(\mathbf{r} + 2\mathbf{p})$$

(3)

Question 2 continued

Question T10_Q5

6.

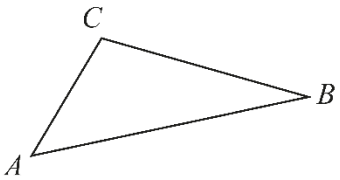

Figure 1

Figure 1 shows a sketch of triangle ABC.

Given that

- $\overrightarrow{AB} = -3\mathbf{i} - 4\mathbf{j} - 5\mathbf{k}$
- $\overrightarrow{BC} = \mathbf{i} + \mathbf{j} + 4\mathbf{k}$

(a) find $\overrightarrow{AC}$

(2)

(b) show that $\cos ABC = \dfrac{9}{10}$

(3)

Question 6 continued

Question 6 continued

Question 6 continued